Add and subtract 2-digit and 3-digit numbers – not crossing 10 or 100

1 Work out the additions.

a)

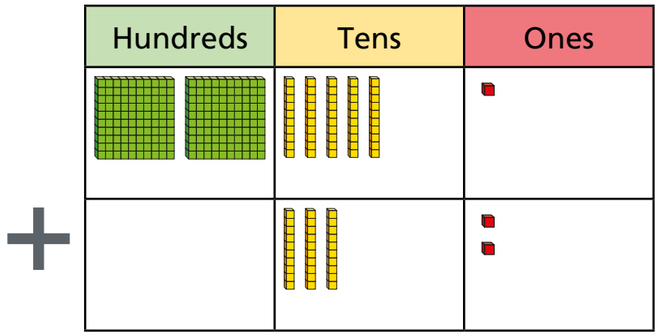

		H	T	O	
		2	5	1	
	+		3	2	
		2	8	3	

b)

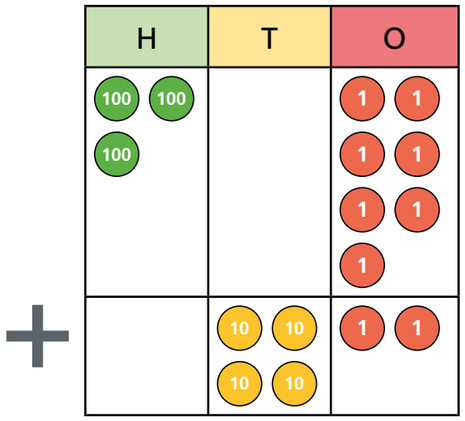

		H	T	O	
		3	0	7	
	+		4	2	
		3	4	9	

c)

		H	T	O	
		2	3	7	
	+		5	1	
		2	8	8	

d)

		H	T	O	
		7	5	2	
	+		3	7	
		7	8	9	

2 Work out these subtractions.

a)

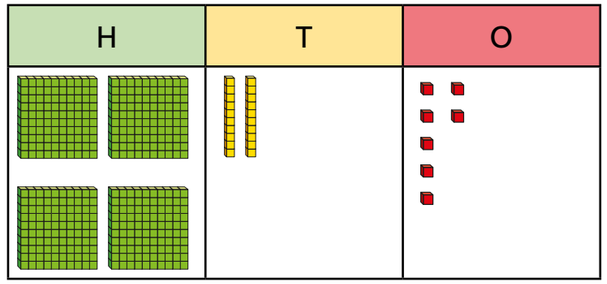

		H	T	O	
		4	2	7	
	–		1	5	
		4	1	2	

b)

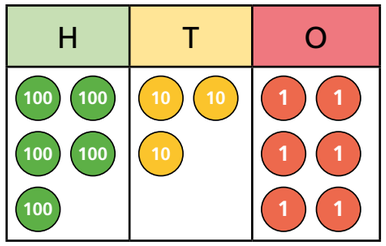

		H	T	O	
		5	3	6	
	–		3	5	
		5	0	1	

c)

		H	T	O	
		7	8	5	
	–		5	2	
		7	3	3	

d)

		H	T	O	
		9	8	5	
	–		7	2	
		9	1	3	

3 Complete the additions.

a) £69 + £220 = £ 289

b) 314 + 42 + 23 = 379

© White Rose Maths 2019

4 **a)** Eva uses a number line to work out 312 + 37

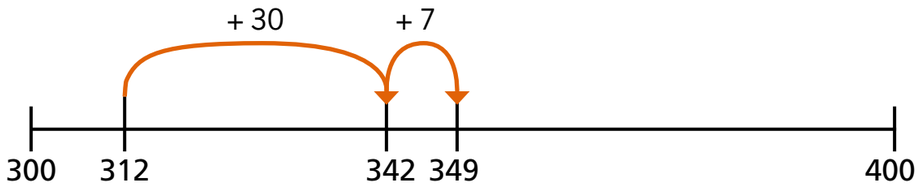

What has Eva done? Talk to a partner.

b) Use the number line to work out 425 + 63

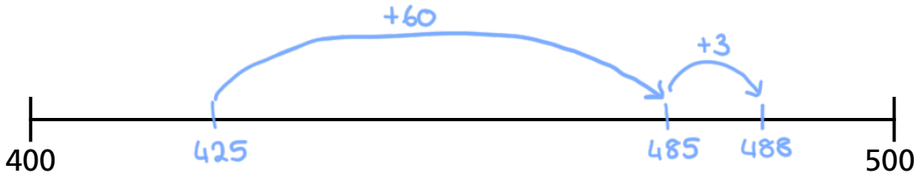

488

c) Use the number line to work out 774 – 62

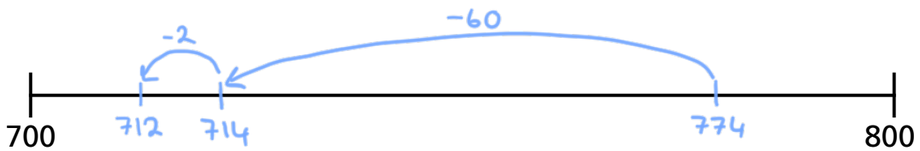

712

5 Esther has a piece of wood 255 cm long.

She cuts it into 2 pieces.

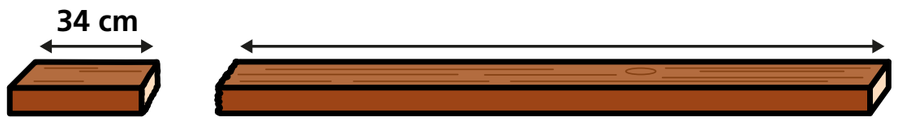

One piece is 34 cm long.

How long is the other piece?

221cm

6 Filip wants to buy these two items.

He has £200

Does he have enough money? Yes

How do you know? Talk to a partner.

7 Use the digit cards to make each calculation correct.

1	3	6	7	9

	H	T	O
	9	6	7
+		3	1
	9	9	8

	H	T	O
	9	1	6
+		7	3
	9	8	9

	H	T	O
	1	9	7
–		3	6
	1	6	1

	H	T	O
	6	3	9
–		1	7
	6	2	2

© White Rose Maths 2019